Nome: _____ ; Cognome: _____ ; Classe:_____; Data: _____ ;

Elena ha preso un foglio e lo ha piegato in due seguendo la linea tratteggiata. Questo è ciò che ottiene:

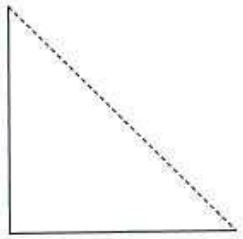

Che forma aveva inizialmente il foglio che Elena ha piegato?

☐ A.



☐ B.



☐ C.

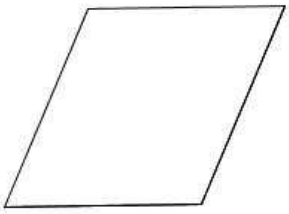

Quanti triangoli vedi nel disegno della barchetta?

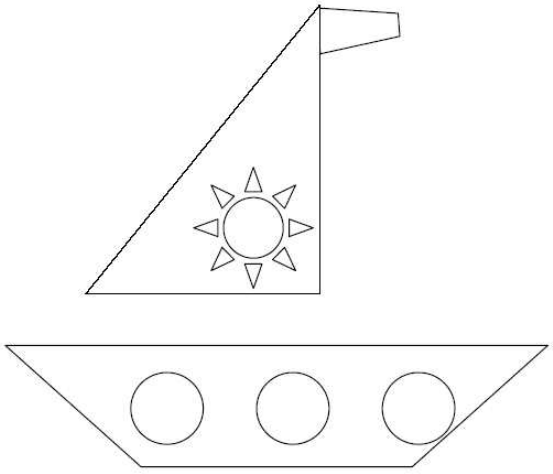

☐ A. 8

☐ B. 9

☐ C. 10

Andrea ha fatto un buco in un cartoncino:



Qual è il pezzo che ha tagliato?

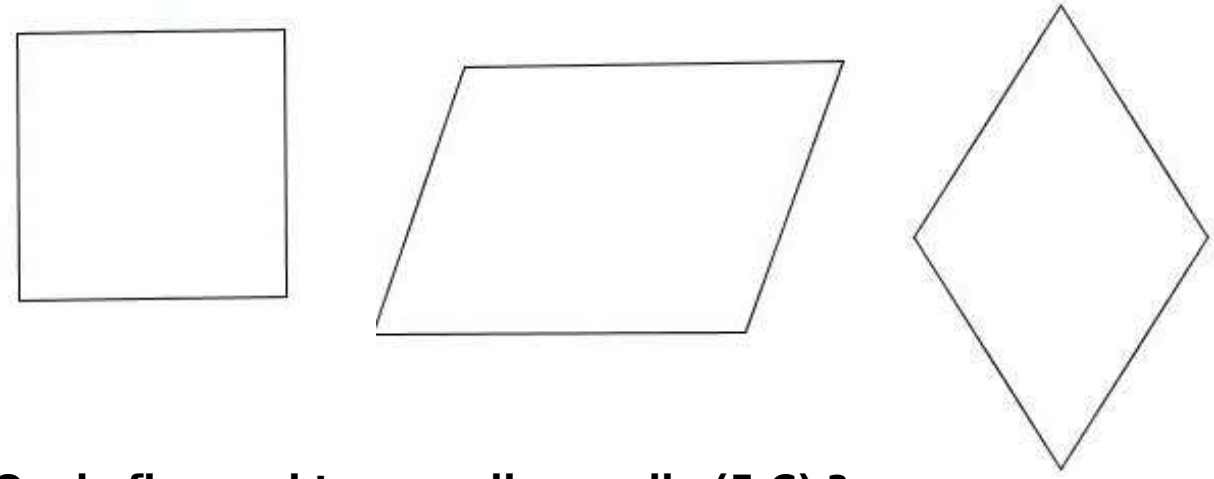

Quale figura si trova nella casella (5,C) ?

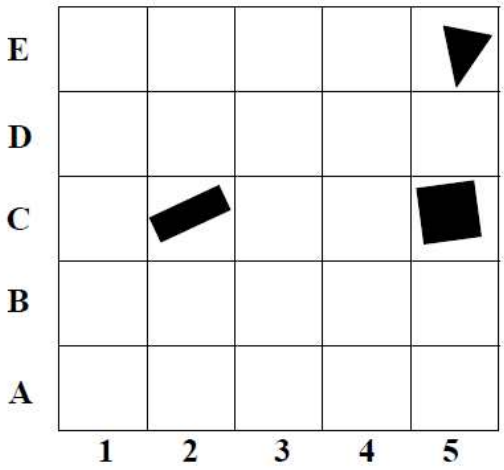

- ☐ A. Triangolo.
- ☐ B. Quadrato.
- ☐ C. Rettangolo.

Osserva la barchetta.

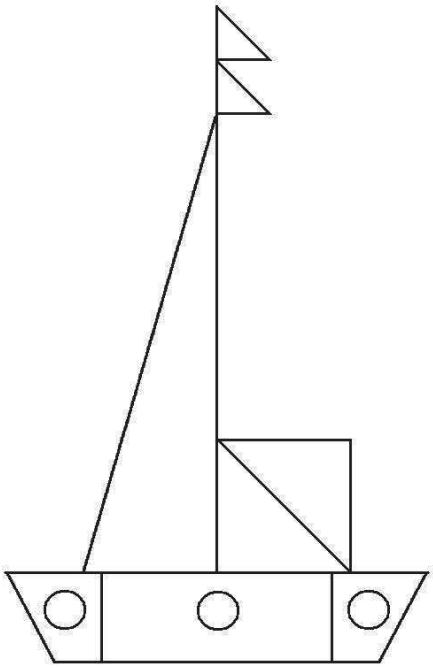

In tutto i triangoli sono:

- ☐ A. 3
- ☐ B. 5
- ☐ C. 7

Quanti triangoli vedi nel pesce?

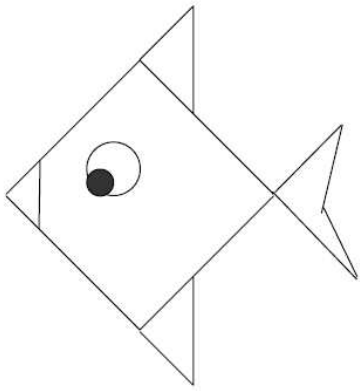

- ☐ A. 3
- ☐ B. 4
- ☐ C. 5

Quanti triangoli vedi nella figura?

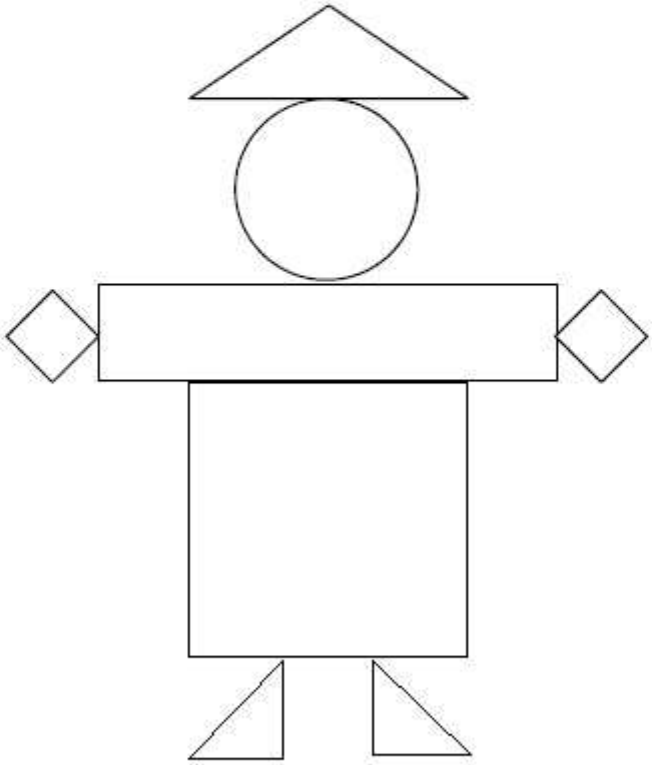

- ☐ A. 2
- ☐ B. 3
- ☐ C. 5

Quale pezzo manca?

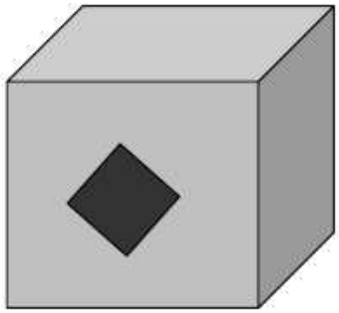

- ☐ A.
- ☐ B.
- ☐ C.